


# Measure with a real ruler — five questions

**Success criteria**
I can line up zero with one end and read the length at the other end.

Name: _____ Date: _____

Use inches. Start at zero. Read the mark at the far end.

Print on US Letter at 100% / Actual size. Do not use Fit to page.

1. Measure this bar. Length: _____ inches



2. Measure this bar. Length: _____ inches



3. Measure this bar. Length: _____ inches



4. Measure a pencil. Estimate: _____ inches. Measure: _____ inches.
   Tell how your estimate and measurement compare.

_____

5. Measure an eraser. Estimate: _____ inches. Measure: _____ inches.
   Tell whether it is shorter or longer than your pencil.

_____

Adult print check: the line below must measure exactly 1 inch (2.54 cm).

_____

If the check fails, use classroom objects instead of the printed bars.




# Measure with a real ruler — five questions

**Success criteria**

I can line up zero with one end and read the length at the other end.

Name: _____ Date: _____

Use centimeters. Start at zero. Read the mark at the far end.

Print on US Letter at 100% / Actual size. Do not use Fit to page.

1. Measure this bar. Length: _____ centimeters



2. Measure this bar. Length: _____ centimeters



3. Measure this bar. Length: _____ centimeters



4. Measure a pencil. Estimate: _____ centimeters. Measure: _____ centimeters.
   Tell how your estimate and measurement compare.

_____

5. Measure an eraser. Estimate: _____ centimeters. Measure: _____ centimeters.
   Tell whether it is shorter or longer than your pencil.

_____

Adult print check: the line below must measure exactly 1 inch (2.54 cm).

_____

If the check fails, use classroom objects instead of the printed bars.