

WORKSHEET OUTPOST | Grade 2 Math

Can every object have a partner?

OW-G2-048 | Five questions

Success criteria
I can make pairs and tell if a number is odd or even.

Name: _____ Date: _____

Read each problem or listen as someone reads it. Show your thinking with objects, pictures, words, or numbers.

1. Is 8 even or odd? Draw pairs. Explain.

2. Is 11 even or odd? Draw pairs. Explain.

3. Is 14 even or odd? Draw pairs. Explain.

4. Is 17 even or odd? Draw pairs. Explain.

5. Write a problem like question 1 with new numbers or objects. Solve it and show your work.

You can point, speak, draw, or write. Adults can note any help they give.



WORKSHEET OUTPOST | Grade 2 Math

Count objects arranged in rows

OW-G2-049 | Five questions

Success criteria

I can add equal rows to find how many objects there are.

Name: _____ Date: _____

Read each problem or listen as someone reads it. Show your thinking with objects, pictures, words, or numbers.

1. Count the rows. Then count the objects in one row. Write a repeated-addition equation.

○ ○ ○
○ ○ ○

2. Count the rows. Then count the objects in one row. Write a repeated-addition equation.

○ ○ ○ ○
○ ○ ○ ○
○ ○ ○ ○

3. Count the rows. Then count the objects in one row. Write a repeated-addition equation.

○ ○ ○ ○ ○
○ ○ ○ ○ ○
○ ○ ○ ○ ○
○ ○ ○ ○ ○

4. Count the rows. Then count the objects in one row. Write a repeated-addition equation.

○ ○
○ ○
○ ○
○ ○
○ ○

5. Write a problem like question 1 with new numbers or objects. Solve it and show your work.

You can point, speak, draw, or write. Adults can note any help they give.



WORKSHEET OUTPOST | Grade 2 Math

Draw rows with equal amounts

OW-G2-050 | Five questions

Success criteria
I can add equal rows to find how many objects there are.

Name: _____ Date: _____

Read each problem or listen as someone reads it. Show your thinking with objects, pictures, words, or numbers.

1. Draw 2 rows with 3 dots in each row. Write an addition equation.

2. Draw 3 rows with 4 dots in each row. Write an addition equation.

3. Draw 4 rows with 5 dots in each row. Write an addition equation.

4. Draw 5 rows with 2 dots in each row. Write an addition equation.

5. Write a problem like question 1 with new numbers or objects. Solve it and show your work.

You can point, speak, draw, or write. Adults can note any help they give.



WORKSHEET OUTPOST | Grade 2 Math

Model a grouping story

OW-G2-051 | Five questions

Success criteria
I can add equal rows to find how many objects there are.

Name: _____ Date: _____

Read each problem or listen as someone reads it. Show your thinking with objects, pictures, words, or numbers.

1. There are 2 trays with 3 cups on each tray. Draw an array and find the total.

2. There are 3 trays with 4 cups on each tray. Draw an array and find the total.

3. There are 4 trays with 5 cups on each tray. Draw an array and find the total.

4. There are 5 trays with 2 cups on each tray. Draw an array and find the total.

5. Write a problem like question 1 with new numbers or objects. Solve it and show your work.

You can point, speak, draw, or write. Adults can note any help they give.



WORKSHEET OUTPOST | Grade 2 Math

Make pairs to find even and odd numbers

OW-G2-052 | Five questions

Success criteria
I can make pairs and tell if a number is odd or even.

Name: _____ Date: _____

Read each problem or listen as someone reads it. Show your thinking with objects, pictures, words, or numbers.

1. Is 6 even or odd? Draw pairs. Write two equal addends if possible.

2. Is 13 even or odd? Draw pairs. Write two equal addends if possible.

3. Is 16 even or odd? Draw pairs. Write two equal addends if possible.

4. Is 19 even or odd? Draw pairs. Write two equal addends if possible.

5. Write a problem like question 1 with new numbers or objects. Solve it and show your work.

You can point, speak, draw, or write. Adults can note any help they give.