

WORKSHEET OUTPOST | Grade 2 Math — Supported

Two-digit sums with block drawings

OW-G2-022 E1 | Five questions

Success criteria
I can use tens and ones to add or subtract within 100.

Name: _____ Date: _____

Listen as an adult reads each question. Use counters or draw a picture to solve it.

1. 33 + 16 = ___. Draw tens and ones. Regroup if needed.

2. 42 + 27 = ___. Draw tens and ones. Regroup if needed.

3. 51 + 28 = ___. Draw tens and ones. Regroup if needed.

4. 63 + 20 = ___. Draw tens and ones. Regroup if needed.

5. Write a problem like question 1 with new numbers or objects. Solve it and show your work.

You can point, speak, draw, or write. Adults can note any help they give.



WORKSHEET OUTPOST | Grade 2 Math — Supported

Two-digit sums with block drawings

Success criteria
I can use tens and ones to add or subtract within 100.

OW-G2-022 E2 | Five questions

Name: _____ Date: _____

Work with a partner. Build a model, then say or write your answer.

1. 33 + 16 = ___. Draw tens and ones. Regroup if needed.

2. 42 + 27 = ___. Draw tens and ones. Regroup if needed.

3. 51 + 28 = ___. Draw tens and ones. Regroup if needed.

4. 63 + 20 = ___. Draw tens and ones. Regroup if needed.

5. Write a problem like question 1 with new numbers or objects. Solve it and show your work.

You can point, speak, draw, or write. Adults can note any help they give.



WORKSHEET OUTPOST | Grade 2 Math — Supported

Two-digit sums with block drawings

OW-G2-022 E3 | Five questions

Success criteria
I can use tens and ones to add or subtract within 100.

Name: _____ Date: _____

Work with a helper. Use objects, a number line, or a drawing to solve each problem.

1. 33 + 16 = ___. Draw tens and ones. Regroup if needed.

2. 42 + 27 = ___. Draw tens and ones. Regroup if needed.

3. 51 + 28 = ___. Draw tens and ones. Regroup if needed.

4. 63 + 20 = ___. Draw tens and ones. Regroup if needed.

5. Write a problem like question 1 with new numbers or objects. Solve it and show your work.

You can point, speak, draw, or write. Adults can note any help they give.



WORKSHEET OUTPOST | Grade 2 Math — Supported

Two-digit sums with block drawings

OW-G2-022 E4 | Five questions

Success criteria
I can use tens and ones to add or subtract within 100.

Name: _____ Date: _____

Ask an adult to show you how to start. Then finish the problem together.

1. 33 + 16 = ___. Draw tens and ones. Regroup if needed.

2. 42 + 27 = ___. Draw tens and ones. Regroup if needed.

3. 51 + 28 = ___. Draw tens and ones. Regroup if needed.

4. 63 + 20 = ___. Draw tens and ones. Regroup if needed.

5. Write a problem like question 1 with new numbers or objects. Solve it and show your work.

You can point, speak, draw, or write. Adults can note any help they give.



WORKSHEET OUTPOST | Grade 2 Math — Supported

Two-digit sums with block drawings

OW-G2-022 E5 | Five questions

Success criteria
I can use tens and ones to add or subtract within 100.

Name: _____ Date: _____

Try each problem. Tell an adult how you solved it. The adult can write down your answers.

1. 33 + 16 = ___. Draw tens and ones. Regroup if needed.

2. 42 + 27 = ___. Draw tens and ones. Regroup if needed.

3. 51 + 28 = ___. Draw tens and ones. Regroup if needed.

4. 63 + 20 = ___. Draw tens and ones. Regroup if needed.

5. Write a problem like question 1 with new numbers or objects. Solve it and show your work.

You can point, speak, draw, or write. Adults can note any help they give.