

WORKSHEET OUTPOST | Grade 2 Math — Supported

Tell time to the nearest five minutes

OW-G2-106 E1 | Five questions

Success criteria
I can read the hour and minute hands to tell the time.

Name: _____ Date: _____

Listen as an adult reads each question. Use counters or draw a picture to solve it.

1. Write the time. What does each hand tell you?



2. Write the time. What does each hand tell you?



3. Write the time. What does each hand tell you?



4. Write the time. What does each hand tell you?



5. Write a problem like question 1 with new numbers or objects. Solve it and show your work.

You can point, speak, draw, or write. Adults can note any help they give.



WORKSHEET OUTPOST | Grade 2 Math — Supported

Tell time to the nearest five minutes

OW-G2-106 E2 | Five questions

Success criteria
I can read the hour and minute hands to tell the time.

Name: _____ Date: _____

Work with a partner. Build a model, then say or write your answer.

1. Write the time. What does each hand tell you?



2. Write the time. What does each hand tell you?



3. Write the time. What does each hand tell you?



4. Write the time. What does each hand tell you?



5. Write a problem like question 1 with new numbers or objects. Solve it and show your work.

You can point, speak, draw, or write. Adults can note any help they give.



WORKSHEET OUTPOST | Grade 2 Math — Supported

Tell time to the nearest five minutes

OW-G2-106 E3 | Five questions

Success criteria
I can read the hour and minute hands to tell the time.

Name: _____ Date: _____

Work with a helper. Use objects, a number line, or a drawing to solve each problem.

1. Write the time. What does each hand tell you?



2. Write the time. What does each hand tell you?



3. Write the time. What does each hand tell you?



4. Write the time. What does each hand tell you?



5. Write a problem like question 1 with new numbers or objects. Solve it and show your work.

You can point, speak, draw, or write. Adults can note any help they give.



WORKSHEET OUTPOST | Grade 2 Math — Supported

Tell time to the nearest five minutes

OW-G2-106 E4 | Five questions

Success criteria
I can read the hour and minute hands to tell the time.

Name: _____ Date: _____

Ask an adult to show you how to start. Then finish the problem together.

1. Write the time. What does each hand tell you?



2. Write the time. What does each hand tell you?



3. Write the time. What does each hand tell you?



4. Write the time. What does each hand tell you?



5. Write a problem like question 1 with new numbers or objects. Solve it and show your work.

You can point, speak, draw, or write. Adults can note any help they give.



WORKSHEET OUTPOST | Grade 2 Math — Supported

Tell time to the nearest five minutes

OW-G2-106 E5 | Five questions

Success criteria
I can read the hour and minute hands to tell the time.

Name: _____ Date: _____

Try each problem. Tell an adult how you solved it. The adult can write down your answers.

1. Write the time. What does each hand tell you?



2. Write the time. What does each hand tell you?



3. Write the time. What does each hand tell you?



4. Write the time. What does each hand tell you?



5. Write a problem like question 1 with new numbers or objects. Solve it and show your work.

You can point, speak, draw, or write. Adults can note any help they give.