

WORKSHEET OUTPOST | Grade 2 Math — Supported

How much longer is it?

OW-G2-061 E1 | Five questions

Success criteria

I can add or subtract lengths and label my answer with the unit.

Name: _____ Date: _____

Listen as an adult reads each question. Use counters or draw a picture to solve it.

1. One ribbon is 24 cm. Another is 17 cm. How much longer is the first?

2. One ribbon is 29 cm. Another is 19 cm. How much longer is the first?

3. One ribbon is 34 cm. Another is 21 cm. How much longer is the first?

4. One ribbon is 39 cm. Another is 23 cm. How much longer is the first?

5. Write a problem like question 1 with new numbers or objects. Solve it and show your work.

You can point, speak, draw, or write. Adults can note any help they give.



WORKSHEET OUTPOST | Grade 2 Math — Supported

How much longer is it?

Success criteria
I can add or subtract lengths and label my answer with the unit.

OW-G2-061 E2 | Five questions

Name: _____ Date: _____

Work with a partner. Build a model, then say or write your answer.

1. One ribbon is 24 cm. Another is 17 cm. How much longer is the first?

2. One ribbon is 29 cm. Another is 19 cm. How much longer is the first?

3. One ribbon is 34 cm. Another is 21 cm. How much longer is the first?

4. One ribbon is 39 cm. Another is 23 cm. How much longer is the first?

5. Write a problem like question 1 with new numbers or objects. Solve it and show your work.

You can point, speak, draw, or write. Adults can note any help they give.



WORKSHEET OUTPOST | Grade 2 Math — Supported

How much longer is it?

OW-G2-061 E3 | Five questions

Success criteria

I can add or subtract lengths and label my answer with the unit.

Name: _____ Date: _____

Work with a helper. Use objects, a number line, or a drawing to solve each problem.

1. One ribbon is 24 cm. Another is 17 cm. How much longer is the first?

2. One ribbon is 29 cm. Another is 19 cm. How much longer is the first?

3. One ribbon is 34 cm. Another is 21 cm. How much longer is the first?

4. One ribbon is 39 cm. Another is 23 cm. How much longer is the first?

5. Write a problem like question 1 with new numbers or objects. Solve it and show your work.

You can point, speak, draw, or write. Adults can note any help they give.



WORKSHEET OUTPOST | Grade 2 Math — Supported

How much longer is it?

OW-G2-061 E4 | Five questions

Success criteria

I can add or subtract lengths and label my answer with the unit.

Name: _____ Date: _____

Ask an adult to show you how to start. Then finish the problem together.

1. One ribbon is 24 cm. Another is 17 cm. How much longer is the first?

2. One ribbon is 29 cm. Another is 19 cm. How much longer is the first?

3. One ribbon is 34 cm. Another is 21 cm. How much longer is the first?

4. One ribbon is 39 cm. Another is 23 cm. How much longer is the first?

5. Write a problem like question 1 with new numbers or objects. Solve it and show your work.

You can point, speak, draw, or write. Adults can note any help they give.



WORKSHEET OUTPOST | Grade 2 Math — Supported

How much longer is it?

OW-G2-061 E5 | Five questions

Success criteria
I can add or subtract lengths and label my answer with the unit.

Name: _____ Date: _____

Try each problem. Tell an adult how you solved it. The adult can write down your answers.

1. One ribbon is 24 cm. Another is 17 cm. How much longer is the first?

2. One ribbon is 29 cm. Another is 19 cm. How much longer is the first?

3. One ribbon is 34 cm. Another is 21 cm. How much longer is the first?

4. One ribbon is 39 cm. Another is 23 cm. How much longer is the first?

5. Write a problem like question 1 with new numbers or objects. Solve it and show your work.

You can point, speak, draw, or write. Adults can note any help they give.