

WORKSHEET OUTPOST | Grade 2 Math — Supported

Explore a cube

Success criteria
I can identify a shape by its sides and corners.

OW-G2-081 E1 | Five questions

Name: _____ Date: _____

Listen as an adult reads each question. Use counters or draw a picture to solve it.

1. Draw a cube. How many square faces does it have?

2. How many edges does a cube have?

3. How many vertices does a cube have?

4. Name a real object shaped like a cube. Explain using its faces.

5. Write a problem like question 1 with new numbers or objects. Solve it and show your work.

You can point, speak, draw, or write. Adults can note any help they give.



WORKSHEET OUTPOST | Grade 2 Math — Supported

Explore a cube

OW-G2-081 E2 | Five questions

Success criteria

I can identify a shape by its sides and corners.

Name: _____ Date: _____

Work with a partner. Build a model, then say or write your answer.

1. Draw a cube. How many square faces does it have?

2. How many edges does a cube have?

3. How many vertices does a cube have?

4. Name a real object shaped like a cube. Explain using its faces.

5. Write a problem like question 1 with new numbers or objects. Solve it and show your work.

You can point, speak, draw, or write. Adults can note any help they give.



WORKSHEET OUTPOST | Grade 2 Math — Supported

Explore a cube

Success criteria
I can identify a shape by its sides and corners.

OW-G2-081 E3 | Five questions

Name: _____ Date: _____

Work with a helper. Use objects, a number line, or a drawing to solve each problem.

1. Draw a cube. How many square faces does it have?

2. How many edges does a cube have?

3. How many vertices does a cube have?

4. Name a real object shaped like a cube. Explain using its faces.

5. Write a problem like question 1 with new numbers or objects. Solve it and show your work.

You can point, speak, draw, or write. Adults can note any help they give.



WORKSHEET OUTPOST | Grade 2 Math — Supported

Explore a cube

OW-G2-081 E4 | Five questions

Success criteria
I can identify a shape by its sides and corners.

Name: _____ Date: _____

Ask an adult to show you how to start. Then finish the problem together.

1. Draw a cube. How many square faces does it have?

2. How many edges does a cube have?

3. How many vertices does a cube have?

4. Name a real object shaped like a cube. Explain using its faces.

5. Write a problem like question 1 with new numbers or objects. Solve it and show your work.

You can point, speak, draw, or write. Adults can note any help they give.



WORKSHEET OUTPOST | Grade 2 Math — Supported

Explore a cube

Success criteria
I can identify a shape by its sides and corners.

OW-G2-081 E5 | Five questions

Name: _____ Date: _____

Try each problem. Tell an adult how you solved it. The adult can write down your answers.

1. Draw a cube. How many square faces does it have?

2. How many edges does a cube have?

3. How many vertices does a cube have?

4. Name a real object shaped like a cube. Explain using its faces.

5. Write a problem like question 1 with new numbers or objects. Solve it and show your work.

You can point, speak, draw, or write. Adults can note any help they give.