

WORKSHEET OUTPOST | Grade 1 Math

Teen numbers as ten and more

OW-G1-135 | Five questions

Success criteria

I can show how many tens and ones are in a number.

Name: _____ Date: _____

Read each problem or listen as someone reads it. Show your thinking with objects, pictures, words, or numbers.

1. Build 11 on the ten-frames. Complete 10 + ___ = 11.

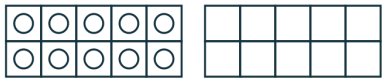

2. Build 13 on the ten-frames. Complete 10 + ___ = 13.

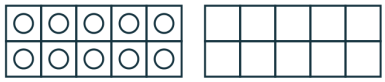

3. Build 15 on the ten-frames. Complete 10 + ___ = 15.

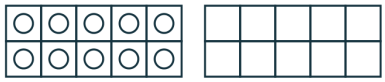

4. Build 17 on the ten-frames. Complete 10 + ___ = 17.

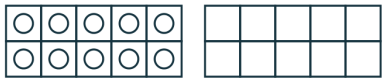

5. Write a problem like question 1 with new numbers or objects. Solve it and show your work.

You can point, speak, draw, or write. Adults can note any help they give.