

WORKSHEET OUTPOST | Grade 1 Math

Extra practice: compare equal shares

Success criteria
I can divide a shape into equal parts and name each share.

OW-G1-142 | Five questions

Name: _____ Date: _____

Read each problem or listen as someone reads it. Show your thinking with objects, pictures, words, or numbers.

1. The two wholes are the same size. Which shaded part is larger?

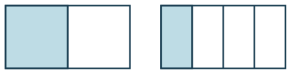

2. How many halves make one whole?

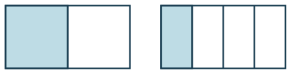

3. How many fourths make one whole?

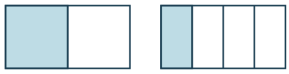

4. Which whole has more equal parts: left or right?

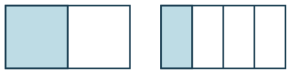

5. Which shaded share is smaller?

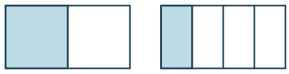

You can point, speak, draw, or write. Adults can note any help they give.