

WORKSHEET OUTPOST | Grade 1 Math — Supported

Getting ready: Finding Missing Parts of Numbers 6 to 9

OW-G1-099 E1 | Five questions

Success criteria

I can find the missing part in an addition story.

Name: _____ Date: _____

Listen as an adult reads each question. Use counters or draw a picture to solve it.

1. There are 6 blocks. 2 are in a box. How many are outside? Complete 2 + ___ = 6.

2. There are 7 blocks. 3 are in a box. How many are outside? Complete 3 + ___ = 7.

3. There are 8 blocks. 4 are in a box. How many are outside? Complete 4 + ___ = 8.

4. There are 9 blocks. 5 are in a box. How many are outside? Complete 5 + ___ = 9.

5. Write a problem like question 1 with new numbers or objects. Solve it and show your work.

You can point, speak, draw, or write. Adults can note any help they give.



WORKSHEET OUTPOST | Grade 1 Math — Supported

Getting ready: Finding Missing Parts of Numbers 6 to 9

OW-G1-099 E2 | Five questions

Success criteria

I can find the missing part in an addition story.

Name: _____ Date: _____

Work with a partner. Build a model, then say or write your answer.

1. There are 6 blocks. 2 are in a box. How many are outside? Complete 2 + ___ = 6.

2. There are 7 blocks. 3 are in a box. How many are outside? Complete 3 + ___ = 7.

3. There are 8 blocks. 4 are in a box. How many are outside? Complete 4 + ___ = 8.

4. There are 9 blocks. 5 are in a box. How many are outside? Complete 5 + ___ = 9.

5. Write a problem like question 1 with new numbers or objects. Solve it and show your work.

You can point, speak, draw, or write. Adults can note any help they give.



WORKSHEET OUTPOST | Grade 1 Math — Supported

Getting ready: Finding Missing Parts of Numbers 6 to 9

OW-G1-099 E3 | Five questions

Success criteria

I can find the missing part in an addition story.

Name: _____ Date: _____

Work with a helper. Use objects, a number line, or a drawing to solve each problem.

1. There are 6 blocks. 2 are in a box. How many are outside? Complete 2 + ___ = 6.

2. There are 7 blocks. 3 are in a box. How many are outside? Complete 3 + ___ = 7.

3. There are 8 blocks. 4 are in a box. How many are outside? Complete 4 + ___ = 8.

4. There are 9 blocks. 5 are in a box. How many are outside? Complete 5 + ___ = 9.

5. Write a problem like question 1 with new numbers or objects. Solve it and show your work.

You can point, speak, draw, or write. Adults can note any help they give.



WORKSHEET OUTPOST | Grade 1 Math — Supported

Getting ready: Finding Missing Parts of Numbers 6 to 9

OW-G1-099 E4 | Five questions

Success criteria

I can find the missing part in an addition story.

Name: _____ Date: _____

Ask an adult to show you how to start. Then finish the problem together.

1. There are 6 blocks. 2 are in a box. How many are outside? Complete 2 + ___ = 6.

2. There are 7 blocks. 3 are in a box. How many are outside? Complete 3 + ___ = 7.

3. There are 8 blocks. 4 are in a box. How many are outside? Complete 4 + ___ = 8.

4. There are 9 blocks. 5 are in a box. How many are outside? Complete 5 + ___ = 9.

5. Write a problem like question 1 with new numbers or objects. Solve it and show your work.

You can point, speak, draw, or write. Adults can note any help they give.



WORKSHEET OUTPOST | Grade 1 Math — Supported

Getting ready: Finding Missing Parts of Numbers 6 to 9

OW-G1-099 E5 | Five questions

Success criteria

I can find the missing part in an addition story.

Name: _____ Date: _____

Try each problem. Tell an adult how you solved it. The adult can write down your answers.

1. There are 6 blocks. 2 are in a box. How many are outside? Complete 2 + ___ = 6.

2. There are 7 blocks. 3 are in a box. How many are outside? Complete 3 + ___ = 7.

3. There are 8 blocks. 4 are in a box. How many are outside? Complete 4 + ___ = 8.

4. There are 9 blocks. 5 are in a box. How many are outside? Complete 5 + ___ = 9.

5. Write a problem like question 1 with new numbers or objects. Solve it and show your work.

You can point, speak, draw, or write. Adults can note any help they give.