

WORKSHEET OUTPOST | Grade 1 Math — Supported

How many more or fewer?

Success criteria
I can choose addition or subtraction to solve a story problem.

OW-G1-083 E1 | Five questions

Name: _____ Date: _____

Listen as an adult reads each question. Use counters or draw a picture to solve it.

1. Ana has 5 cubes. Bo has 3. How many more does Ana have? Draw matching pairs.

2. Ana has 5 cubes. Bo has 4. How many more does Ana have? Draw matching pairs.

3. Ana has 8 cubes. Bo has 5. How many more does Ana have? Draw matching pairs.

4. Ana has 8 cubes. Bo has 6. How many more does Ana have? Draw matching pairs.

5. Write a problem like question 1 with new numbers or objects. Solve it and show your work.

You can point, speak, draw, or write. Adults can note any help they give.



WORKSHEET OUTPOST | Grade 1 Math — Supported

How many more or fewer?

Success criteria
I can choose addition or subtraction to solve a story problem.

OW-G1-083 E2 | Five questions

Name: _____ Date: _____

Work with a partner. Build a model, then say or write your answer.

1. Ana has 5 cubes. Bo has 3. How many more does Ana have? Draw matching pairs.

2. Ana has 5 cubes. Bo has 4. How many more does Ana have? Draw matching pairs.

3. Ana has 8 cubes. Bo has 5. How many more does Ana have? Draw matching pairs.

4. Ana has 8 cubes. Bo has 6. How many more does Ana have? Draw matching pairs.

5. Write a problem like question 1 with new numbers or objects. Solve it and show your work.

You can point, speak, draw, or write. Adults can note any help they give.



WORKSHEET OUTPOST | Grade 1 Math — Supported

How many more or fewer?

Success criteria
I can choose addition or subtraction to solve a story problem.

OW-G1-083 E3 | Five questions

Name: _____ Date: _____

Work with a helper. Use objects, a number line, or a drawing to solve each problem.

1. Ana has 5 cubes. Bo has 3. How many more does Ana have? Draw matching pairs.

2. Ana has 5 cubes. Bo has 4. How many more does Ana have? Draw matching pairs.

3. Ana has 8 cubes. Bo has 5. How many more does Ana have? Draw matching pairs.

4. Ana has 8 cubes. Bo has 6. How many more does Ana have? Draw matching pairs.

5. Write a problem like question 1 with new numbers or objects. Solve it and show your work.

You can point, speak, draw, or write. Adults can note any help they give.



WORKSHEET OUTPOST | Grade 1 Math — Supported

How many more or fewer?

Success criteria
I can choose addition or subtraction to solve a story problem.

OW-G1-083 E4 | Five questions

Name: _____ Date: _____

Ask an adult to show you how to start. Then finish the problem together.

1. Ana has 5 cubes. Bo has 3. How many more does Ana have? Draw matching pairs.

2. Ana has 5 cubes. Bo has 4. How many more does Ana have? Draw matching pairs.

3. Ana has 8 cubes. Bo has 5. How many more does Ana have? Draw matching pairs.

4. Ana has 8 cubes. Bo has 6. How many more does Ana have? Draw matching pairs.

5. Write a problem like question 1 with new numbers or objects. Solve it and show your work.

You can point, speak, draw, or write. Adults can note any help they give.



WORKSHEET OUTPOST | Grade 1 Math — Supported

How many more or fewer?

Success criteria
I can choose addition or subtraction to solve a story problem.

OW-G1-083 E5 | Five questions

Name: _____ Date: _____

Try each problem. Tell an adult how you solved it. The adult can write down your answers.

1. Ana has 5 cubes. Bo has 3. How many more does Ana have? Draw matching pairs.

2. Ana has 5 cubes. Bo has 4. How many more does Ana have? Draw matching pairs.

3. Ana has 8 cubes. Bo has 5. How many more does Ana have? Draw matching pairs.

4. Ana has 8 cubes. Bo has 6. How many more does Ana have? Draw matching pairs.

5. Write a problem like question 1 with new numbers or objects. Solve it and show your work.

You can point, speak, draw, or write. Adults can note any help they give.