

WORKSHEET OUTPOST | Grade 1 Math — Supported

More difference stories

OW-G1-087 E1 | Five questions

Success criteria

I can choose addition or subtraction to solve a story problem.

Name: _____ Date: _____

Listen as an adult reads each question. Use counters or draw a picture to solve it.

1. Bo has 3 cubes. Ana has 2 more than Bo. How many cubes does Ana have?

2. Ana has 5 cubes. Bo has 1 fewer than Ana. How many does Bo have?

3. Bo has 5 cubes. Ana has 3 more than Bo. How many cubes does Ana have?

4. Ana has 8 cubes. Bo has 2 fewer than Ana. How many does Bo have?

5. Write a problem like question 1 with new numbers or objects. Solve it and show your work.

You can point, speak, draw, or write. Adults can note any help they give.



WORKSHEET OUTPOST | Grade 1 Math — Supported

More difference stories

OW-G1-087 E2 | Five questions

Success criteria

I can choose addition or subtraction to solve a story problem.

Name: _____ Date: _____

Work with a partner. Build a model, then say or write your answer.

1. Bo has 3 cubes. Ana has 2 more than Bo. How many cubes does Ana have?

2. Ana has 5 cubes. Bo has 1 fewer than Ana. How many does Bo have?

3. Bo has 5 cubes. Ana has 3 more than Bo. How many cubes does Ana have?

4. Ana has 8 cubes. Bo has 2 fewer than Ana. How many does Bo have?

5. Write a problem like question 1 with new numbers or objects. Solve it and show your work.

You can point, speak, draw, or write. Adults can note any help they give.



WORKSHEET OUTPOST | Grade 1 Math — Supported

More difference stories

OW-G1-087 E3 | Five questions

Success criteria

I can choose addition or subtraction to solve a story problem.

Name: _____ Date: _____

Work with a helper. Use objects, a number line, or a drawing to solve each problem.

1. Bo has 3 cubes. Ana has 2 more than Bo. How many cubes does Ana have?

2. Ana has 5 cubes. Bo has 1 fewer than Ana. How many does Bo have?

3. Bo has 5 cubes. Ana has 3 more than Bo. How many cubes does Ana have?

4. Ana has 8 cubes. Bo has 2 fewer than Ana. How many does Bo have?

5. Write a problem like question 1 with new numbers or objects. Solve it and show your work.

You can point, speak, draw, or write. Adults can note any help they give.



WORKSHEET OUTPOST | Grade 1 Math — Supported

More difference stories

OW-G1-087 E4 | Five questions

Success criteria

I can choose addition or subtraction to solve a story problem.

Name: _____ Date: _____

Ask an adult to show you how to start. Then finish the problem together.

1. Bo has 3 cubes. Ana has 2 more than Bo. How many cubes does Ana have?

2. Ana has 5 cubes. Bo has 1 fewer than Ana. How many does Bo have?

3. Bo has 5 cubes. Ana has 3 more than Bo. How many cubes does Ana have?

4. Ana has 8 cubes. Bo has 2 fewer than Ana. How many does Bo have?

5. Write a problem like question 1 with new numbers or objects. Solve it and show your work.

You can point, speak, draw, or write. Adults can note any help they give.



WORKSHEET OUTPOST | Grade 1 Math — Supported

More difference stories

OW-G1-087 E5 | Five questions

Success criteria

I can choose addition or subtraction to solve a story problem.

Name: _____ Date: _____

Try each problem. Tell an adult how you solved it. The adult can write down your answers.

1. Bo has 3 cubes. Ana has 2 more than Bo. How many cubes does Ana have?

2. Ana has 5 cubes. Bo has 1 fewer than Ana. How many does Bo have?

3. Bo has 5 cubes. Ana has 3 more than Bo. How many cubes does Ana have?

4. Ana has 8 cubes. Bo has 2 fewer than Ana. How many does Bo have?

5. Write a problem like question 1 with new numbers or objects. Solve it and show your work.

You can point, speak, draw, or write. Adults can note any help they give.