

WORKSHEET OUTPOST | Grade 1 Math — Supported

Addition stories through twenty

OW-G1-004 E1 | Five questions

Success criteria
I can choose addition or subtraction to solve a story problem.

Name: _____ Date: _____

Listen as an adult reads each question. Use counters or draw a picture to solve it.

1. A tray holds 8 red cups and 3 blue cups. How many cups are there in all? Show how you solved it.

2. A tray holds 9 red cups and 4 blue cups. How many cups are there in all? Show how you solved it.

3. A tray holds 7 red cups and 5 blue cups. How many cups are there in all? Show how you solved it.

4. A tray holds 9 red cups and 6 blue cups. How many cups are there in all? Show how you solved it.

5. Write a problem like question 1 with new numbers or objects. Solve it and show your work.

You can point, speak, draw, or write. Adults can note any help they give.



WORKSHEET OUTPOST | Grade 1 Math — Supported

Addition stories through twenty

OW-G1-004 E2 | Five questions

Success criteria
I can choose addition or subtraction to solve a story problem.

Name: _____ Date: _____

Work with a partner. Build a model, then say or write your answer.

1. A tray holds 8 red cups and 3 blue cups. How many cups are there in all? Show how you solved it.

2. A tray holds 9 red cups and 4 blue cups. How many cups are there in all? Show how you solved it.

3. A tray holds 7 red cups and 5 blue cups. How many cups are there in all? Show how you solved it.

4. A tray holds 9 red cups and 6 blue cups. How many cups are there in all? Show how you solved it.

5. Write a problem like question 1 with new numbers or objects. Solve it and show your work.

You can point, speak, draw, or write. Adults can note any help they give.



WORKSHEET OUTPOST | Grade 1 Math — Supported

Addition stories through twenty

OW-G1-004 E3 | Five questions

Success criteria
I can choose addition or subtraction to solve a story problem.

Name: _____ Date: _____

Work with a helper. Use objects, a number line, or a drawing to solve each problem.

1. A tray holds 8 red cups and 3 blue cups. How many cups are there in all? Show how you solved it.

2. A tray holds 9 red cups and 4 blue cups. How many cups are there in all? Show how you solved it.

3. A tray holds 7 red cups and 5 blue cups. How many cups are there in all? Show how you solved it.

4. A tray holds 9 red cups and 6 blue cups. How many cups are there in all? Show how you solved it.

5. Write a problem like question 1 with new numbers or objects. Solve it and show your work.

You can point, speak, draw, or write. Adults can note any help they give.



WORKSHEET OUTPOST | Grade 1 Math — Supported

Addition stories through twenty

OW-G1-004 E4 | Five questions

Success criteria
I can choose addition or subtraction to solve a story problem.

Name: _____ Date: _____

Ask an adult to show you how to start. Then finish the problem together.

1. A tray holds 8 red cups and 3 blue cups. How many cups are there in all? Show how you solved it.

2. A tray holds 9 red cups and 4 blue cups. How many cups are there in all? Show how you solved it.

3. A tray holds 7 red cups and 5 blue cups. How many cups are there in all? Show how you solved it.

4. A tray holds 9 red cups and 6 blue cups. How many cups are there in all? Show how you solved it.

5. Write a problem like question 1 with new numbers or objects. Solve it and show your work.

You can point, speak, draw, or write. Adults can note any help they give.



WORKSHEET OUTPOST | Grade 1 Math — Supported

Addition stories through twenty

OW-G1-004 E5 | Five questions

Success criteria
I can choose addition or subtraction to solve a story problem.

Name: _____ Date: _____

Try each problem. Tell an adult how you solved it. The adult can write down your answers.

1. A tray holds 8 red cups and 3 blue cups. How many cups are there in all? Show how you solved it.

2. A tray holds 9 red cups and 4 blue cups. How many cups are there in all? Show how you solved it.

3. A tray holds 7 red cups and 5 blue cups. How many cups are there in all? Show how you solved it.

4. A tray holds 9 red cups and 6 blue cups. How many cups are there in all? Show how you solved it.

5. Write a problem like question 1 with new numbers or objects. Solve it and show your work.

You can point, speak, draw, or write. Adults can note any help they give.