

WORKSHEET OUTPOST | Grade 1 Math — Supported

More questions about data

Success criteria
I can read a graph and use the counts to answer a question.

OW-G1-048 E1 | Five questions

Name: _____ Date: _____

Listen as an adult reads each question. Use counters or draw a picture to solve it.

1. How many more votes did dogs get than fish?

Cats	○ ○
Dogs	○ ○ ○ ○
Fish	○

Each circle = 1 vote.

2. How many votes did cats and fish get together?

Cats	○ ○ ○
Dogs	○ ○ ○ ○ ○
Fish	○ ○

Each circle = 1 vote.

3. How many fewer votes did cats get than dogs?

Cats	○ ○ ○ ○
Dogs	○ ○ ○ ○ ○ ○
Fish	○ ○ ○

Each circle = 1 vote.

4. How many more votes do fish need to tie with dogs?

Cats	○ ○ ○ ○ ○
Dogs	○ ○ ○ ○ ○ ○ ○
Fish	○ ○ ○ ○

Each circle = 1 vote.

5. Write a problem like question 1 with new numbers or objects. Solve it and show your work.

You can point, speak, draw, or write. Adults can note any help they give.



WORKSHEET OUTPOST | Grade 1 Math — Supported

More questions about data

Success criteria
I can read a graph and use the counts to answer a question.

OW-G1-048 E2 | Five questions

Name: _____ Date: _____

Work with a partner. Build a model, then say or write your answer.

1. How many more votes did dogs get than fish?

Cats	○ ○
Dogs	○ ○ ○ ○
Fish	○

Each circle = 1 vote.

2. How many votes did cats and fish get together?

Cats	○ ○ ○
Dogs	○ ○ ○ ○ ○
Fish	○ ○

Each circle = 1 vote.

3. How many fewer votes did cats get than dogs?

Cats	○ ○ ○ ○
Dogs	○ ○ ○ ○ ○ ○
Fish	○ ○ ○

Each circle = 1 vote.

4. How many more votes do fish need to tie with dogs?

Cats	○ ○ ○ ○ ○
Dogs	○ ○ ○ ○ ○ ○ ○
Fish	○ ○ ○ ○

Each circle = 1 vote.

5. Write a problem like question 1 with new numbers or objects. Solve it and show your work.

You can point, speak, draw, or write. Adults can note any help they give.



WORKSHEET OUTPOST | Grade 1 Math — Supported

More questions about data

Success criteria
I can read a graph and use the counts to answer a question.

OW-G1-048 E3 | Five questions

Name: _____ Date: _____

Work with a helper. Use objects, a number line, or a drawing to solve each problem.

1. How many more votes did dogs get than fish?

Cats	○ ○
Dogs	○ ○ ○ ○
Fish	○

Each circle = 1 vote.

2. How many votes did cats and fish get together?

Cats	○ ○ ○
Dogs	○ ○ ○ ○ ○
Fish	○ ○

Each circle = 1 vote.

3. How many fewer votes did cats get than dogs?

Cats	○ ○ ○ ○
Dogs	○ ○ ○ ○ ○ ○
Fish	○ ○ ○

Each circle = 1 vote.

4. How many more votes do fish need to tie with dogs?

Cats	○ ○ ○ ○ ○
Dogs	○ ○ ○ ○ ○ ○ ○
Fish	○ ○ ○ ○

Each circle = 1 vote.

5. Write a problem like question 1 with new numbers or objects. Solve it and show your work.



WORKSHEET OUTPOST | Grade 1 Math — Supported

More questions about data

Success criteria
I can read a graph and use the counts to answer a question.

OW-G1-048 E4 | Five questions

Name: _____ Date: _____

Ask an adult to show you how to start. Then finish the problem together.

1. How many more votes did dogs get than fish?

Cats	○ ○
Dogs	○ ○ ○ ○
Fish	○

Each circle = 1 vote.

2. How many votes did cats and fish get together?

Cats	○ ○ ○
Dogs	○ ○ ○ ○ ○
Fish	○ ○

Each circle = 1 vote.

3. How many fewer votes did cats get than dogs?

Cats	○ ○ ○ ○
Dogs	○ ○ ○ ○ ○ ○
Fish	○ ○ ○

Each circle = 1 vote.

4. How many more votes do fish need to tie with dogs?

Cats	○ ○ ○ ○ ○
Dogs	○ ○ ○ ○ ○ ○ ○
Fish	○ ○ ○ ○

Each circle = 1 vote.

5. Write a problem like question 1 with new numbers or objects. Solve it and show your work.

You can point, speak, draw, or write. Adults can note any help they give.



WORKSHEET OUTPOST | Grade 1 Math — Supported

More questions about data

Success criteria
I can read a graph and use the counts to answer a question.

OW-G1-048 E5 | Five questions

Name: _____ Date: _____

Try each problem. Tell an adult how you solved it. The adult can write down your answers.

1. How many more votes did dogs get than fish?

Cats	○ ○
Dogs	○ ○ ○ ○
Fish	○

Each circle = 1 vote.

2. How many votes did cats and fish get together?

Cats	○ ○ ○
Dogs	○ ○ ○ ○ ○
Fish	○ ○

Each circle = 1 vote.

3. How many fewer votes did cats get than dogs?

Cats	○ ○ ○ ○
Dogs	○ ○ ○ ○ ○ ○
Fish	○ ○ ○

Each circle = 1 vote.

4. How many more votes do fish need to tie with dogs?

Cats	○ ○ ○ ○ ○
Dogs	○ ○ ○ ○ ○ ○ ○
Fish	○ ○ ○ ○

Each circle = 1 vote.

5. Write a problem like question 1 with new numbers or objects. Solve it and show your work.

You can point, speak, draw, or write. Adults can note any help they give.