

WORKSHEET OUTPOST | Grade 1 Math — Supported

Place and compare on a number line

OW-G1-132 E1 | Five questions

Name: _____ Date: _____

Success criteria
I can compare two numbers by looking at their place values.

Listen as an adult reads each question. Use counters or draw a picture to solve it.

1. Locate 34 and 43 on the line. Which is farther right, or are they at the same point?

30 32 34 36 38 40 42 44 46 48 50
31 33 35 37 39 41 43 45 47 49

2. Locate 57 and 52 on the line. Which is farther right, or are they at the same point?

50 51 52 53 54 55 56 57 58 59 60

3. Locate 62 and 62 on the line. Which is farther right, or are they at the same point?

60 61 62 63 64 65 66 67 68 69 70

4. Locate 85 and 79 on the line. Which is farther right, or are they at the same point?

70 72 74 76 78 80 82 84 86 88 90
71 73 75 77 79 81 83 85 87 89

5. Write a problem like question 1 with new numbers or objects. Solve it and show your work.

You can point, speak, draw, or write. Adults can note any help they give.



WORKSHEET OUTPOST | Grade 1 Math — Supported

Place and compare on a number line

OW-G1-132 E2 | Five questions

Success criteria
I can compare two numbers by looking at their place values.

Name: _____ Date: _____

Work with a partner. Build a model, then say or write your answer.

1. Locate 34 and 43 on the line. Which is farther right, or are they at the same point?



2. Locate 57 and 52 on the line. Which is farther right, or are they at the same point?

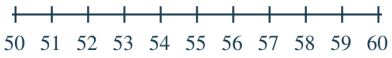

3. Locate 62 and 62 on the line. Which is farther right, or are they at the same point?

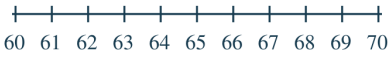

4. Locate 85 and 79 on the line. Which is farther right, or are they at the same point?



5. Write a problem like question 1 with new numbers or objects. Solve it and show your work.

You can point, speak, draw, or write. Adults can note any help they give.



WORKSHEET OUTPOST | Grade 1 Math — Supported

Place and compare on a number line

OW-G1-132 E3 | Five questions

Success criteria
I can compare two numbers by looking at their place values.

Name: _____ Date: _____

Work with a helper. Use objects, a number line, or a drawing to solve each problem.

1. Locate 34 and 43 on the line. Which is farther right, or are they at the same point?

30 32 34 36 38 40 42 44 46 48 50
31 33 35 37 39 41 43 45 47 49

2. Locate 57 and 52 on the line. Which is farther right, or are they at the same point?

50 51 52 53 54 55 56 57 58 59 60

3. Locate 62 and 62 on the line. Which is farther right, or are they at the same point?

60 61 62 63 64 65 66 67 68 69 70

4. Locate 85 and 79 on the line. Which is farther right, or are they at the same point?

70 72 74 76 78 80 82 84 86 88 90
71 73 75 77 79 81 83 85 87 89

5. Write a problem like question 1 with new numbers or objects. Solve it and show your work.

You can point, speak, draw, or write. Adults can note any help they give.



WORKSHEET OUTPOST | Grade 1 Math — Supported

Place and compare on a number line

OW-G1-132 E4 | Five questions

Success criteria
I can compare two numbers by looking at their place values.

Name: _____ Date: _____

Ask an adult to show you how to start. Then finish the problem together.

1. Locate 34 and 43 on the line. Which is farther right, or are they at the same point?



2. Locate 57 and 52 on the line. Which is farther right, or are they at the same point?

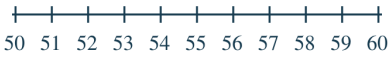

3. Locate 62 and 62 on the line. Which is farther right, or are they at the same point?

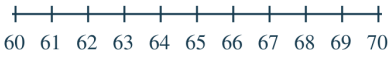

4. Locate 85 and 79 on the line. Which is farther right, or are they at the same point?



5. Write a problem like question 1 with new numbers or objects. Solve it and show your work.

You can point, speak, draw, or write. Adults can note any help they give.



WORKSHEET OUTPOST | Grade 1 Math — Supported

Place and compare on a number line

OW-G1-132 E5 | Five questions

Name: _____ Date: _____

Success criteria
I can compare two numbers by looking at their place values.

Try each problem. Tell an adult how you solved it. The adult can write down your answers.

1. Locate 34 and 43 on the line. Which is farther right, or are they at the same point?

30 32 34 36 38 40 42 44 46 48 50
31 33 35 37 39 41 43 45 47 49

2. Locate 57 and 52 on the line. Which is farther right, or are they at the same point?

50 51 52 53 54 55 56 57 58 59 60

3. Locate 62 and 62 on the line. Which is farther right, or are they at the same point?

60 61 62 63 64 65 66 67 68 69 70

4. Locate 85 and 79 on the line. Which is farther right, or are they at the same point?

70 72 74 76 78 80 82 84 86 88 90
71 73 75 77 79 81 83 85 87 89

5. Write a problem like question 1 with new numbers or objects. Solve it and show your work.

You can point, speak, draw, or write. Adults can note any help they give.