

WORKSHEET OUTPOST | Grade 1 Math — Supported

Combine bundles of ten

Success criteria
I can add two numbers using tens and ones.

OW-G1-007 E1 | Five questions

Name: _____ Date: _____

Listen as an adult reads each question. Use counters or draw a picture to solve it.

1. 20 + 20 = ___. Draw the extra tens rods.



2. 30 + 20 = ___. Draw the extra tens rods.



3. 40 + 20 = ___. Draw the extra tens rods.



4. 50 + 20 = ___. Draw the extra tens rods.



5. Write a problem like question 1 with new numbers or objects. Solve it and show your work.

You can point, speak, draw, or write. Adults can note any help they give.



WORKSHEET OUTPOST | Grade 1 Math — Supported

Combine bundles of ten

Success criteria
I can add two numbers using tens and ones.

OW-G1-007 E2 | Five questions

Name: _____ Date: _____

Work with a partner. Build a model, then say or write your answer.

1. 20 + 20 = ___. Draw the extra tens rods.



2. 30 + 20 = ___. Draw the extra tens rods.



3. 40 + 20 = ___. Draw the extra tens rods.



4. 50 + 20 = ___. Draw the extra tens rods.



5. Write a problem like question 1 with new numbers or objects. Solve it and show your work.

You can point, speak, draw, or write. Adults can note any help they give.



WORKSHEET OUTPOST | Grade 1 Math — Supported

Combine bundles of ten

Success criteria
I can add two numbers using tens and ones.

OW-G1-007 E3 | Five questions

Name: _____ Date: _____

Work with a helper. Use objects, a number line, or a drawing to solve each problem.

1. 20 + 20 = ___. Draw the extra tens rods.



2. 30 + 20 = ___. Draw the extra tens rods.



3. 40 + 20 = ___. Draw the extra tens rods.



4. 50 + 20 = ___. Draw the extra tens rods.



5. Write a problem like question 1 with new numbers or objects. Solve it and show your work.

You can point, speak, draw, or write. Adults can note any help they give.



WORKSHEET OUTPOST | Grade 1 Math — Supported

Combine bundles of ten

Success criteria
I can add two numbers using tens and ones.

OW-G1-007 E4 | Five questions

Name: _____ Date: _____

Ask an adult to show you how to start. Then finish the problem together.

1. 20 + 20 = ___. Draw the extra tens rods.



2. 30 + 20 = ___. Draw the extra tens rods.



3. 40 + 20 = ___. Draw the extra tens rods.



4. 50 + 20 = ___. Draw the extra tens rods.



5. Write a problem like question 1 with new numbers or objects. Solve it and show your work.

You can point, speak, draw, or write. Adults can note any help they give.



WORKSHEET OUTPOST | Grade 1 Math — Supported

Combine bundles of ten

Success criteria
I can add two numbers using tens and ones.

OW-G1-007 E5 | Five questions

Name: _____ Date: _____

Try each problem. Tell an adult how you solved it. The adult can write down your answers.

1. 20 + 20 = ___. Draw the extra tens rods.



2. 30 + 20 = ___. Draw the extra tens rods.



3. 40 + 20 = ___. Draw the extra tens rods.



4. 50 + 20 = ___. Draw the extra tens rods.



5. Write a problem like question 1 with new numbers or objects. Solve it and show your work.

You can point, speak, draw, or write. Adults can note any help they give.