

WORKSHEET OUTPOST | Grade 1 Math — Supported

Draw a two-digit addition model

Success criteria
I can add two numbers using tens and ones.

OW-G1-011 E1 | Five questions

Name: _____ Date: _____

Listen as an adult reads each question. Use counters or draw a picture to solve it.

1. A class has 24 books and gets 13 more. Draw a model and write an equation for the total.

2. A class has 35 books and gets 22 more. Draw a model and write an equation for the total.

3. A class has 46 books and gets 17 more. Draw a model and write an equation for the total.

4. A class has 58 books and gets 15 more. Draw a model and write an equation for the total.

5. Write a problem like question 1 with new numbers or objects. Solve it and show your work.

You can point, speak, draw, or write. Adults can note any help they give.



WORKSHEET OUTPOST | Grade 1 Math — Supported

Draw a two-digit addition model

Success criteria
I can add two numbers using tens and ones.

OW-G1-011 E2 | Five questions

Name: _____ Date: _____

Work with a partner. Build a model, then say or write your answer.

1. A class has 24 books and gets 13 more. Draw a model and write an equation for the total.

2. A class has 35 books and gets 22 more. Draw a model and write an equation for the total.

3. A class has 46 books and gets 17 more. Draw a model and write an equation for the total.

4. A class has 58 books and gets 15 more. Draw a model and write an equation for the total.

5. Write a problem like question 1 with new numbers or objects. Solve it and show your work.

You can point, speak, draw, or write. Adults can note any help they give.



WORKSHEET OUTPOST | Grade 1 Math — Supported

Draw a two-digit addition model

Success criteria
I can add two numbers using tens and ones.

OW-G1-011 E3 | Five questions

Name: _____ Date: _____

Work with a helper. Use objects, a number line, or a drawing to solve each problem.

1. A class has 24 books and gets 13 more. Draw a model and write an equation for the total.

2. A class has 35 books and gets 22 more. Draw a model and write an equation for the total.

3. A class has 46 books and gets 17 more. Draw a model and write an equation for the total.

4. A class has 58 books and gets 15 more. Draw a model and write an equation for the total.

5. Write a problem like question 1 with new numbers or objects. Solve it and show your work.

You can point, speak, draw, or write. Adults can note any help they give.



WORKSHEET OUTPOST | Grade 1 Math — Supported

Draw a two-digit addition model

Success criteria
I can add two numbers using tens and ones.

OW-G1-011 E4 | Five questions

Name: _____ Date: _____

Ask an adult to show you how to start. Then finish the problem together.

1. A class has 24 books and gets 13 more. Draw a model and write an equation for the total.

2. A class has 35 books and gets 22 more. Draw a model and write an equation for the total.

3. A class has 46 books and gets 17 more. Draw a model and write an equation for the total.

4. A class has 58 books and gets 15 more. Draw a model and write an equation for the total.

5. Write a problem like question 1 with new numbers or objects. Solve it and show your work.

You can point, speak, draw, or write. Adults can note any help they give.



WORKSHEET OUTPOST | Grade 1 Math — Supported

Draw a two-digit addition model

Success criteria
I can add two numbers using tens and ones.

OW-G1-011 E5 | Five questions

Name: _____ Date: _____

Try each problem. Tell an adult how you solved it. The adult can write down your answers.

1. A class has 24 books and gets 13 more. Draw a model and write an equation for the total.

2. A class has 35 books and gets 22 more. Draw a model and write an equation for the total.

3. A class has 46 books and gets 17 more. Draw a model and write an equation for the total.

4. A class has 58 books and gets 15 more. Draw a model and write an equation for the total.

5. Write a problem like question 1 with new numbers or objects. Solve it and show your work.

You can point, speak, draw, or write. Adults can note any help they give.