

WORKSHEET OUTPOST | Grade 1 Math — Supported

Draw a tens subtraction model

Success criteria
I can subtract tens and explain how the number changes.

OW-G1-166 E1 | Five questions

Name: _____ Date: _____

Listen as an adult reads each question. Use counters or draw a picture to solve it.

1. A tub holds 50 cubes. 20 are used. Draw a model and find how many are left.

2. A tub holds 60 cubes. 30 are used. Draw a model and find how many are left.

3. A tub holds 70 cubes. 10 are used. Draw a model and find how many are left.

4. A tub holds 90 cubes. 40 are used. Draw a model and find how many are left.

5. Write a problem like question 1 with new numbers or objects. Solve it and show your work.

You can point, speak, draw, or write. Adults can note any help they give.



WORKSHEET OUTPOST | Grade 1 Math — Supported

Draw a tens subtraction model

Success criteria
I can subtract tens and explain how the number changes.

OW-G1-166 E2 | Five questions

Name: _____ Date: _____

Work with a partner. Build a model, then say or write your answer.

1. A tub holds 50 cubes. 20 are used. Draw a model and find how many are left.

2. A tub holds 60 cubes. 30 are used. Draw a model and find how many are left.

3. A tub holds 70 cubes. 10 are used. Draw a model and find how many are left.

4. A tub holds 90 cubes. 40 are used. Draw a model and find how many are left.

5. Write a problem like question 1 with new numbers or objects. Solve it and show your work.

You can point, speak, draw, or write. Adults can note any help they give.



WORKSHEET OUTPOST | Grade 1 Math — Supported

Draw a tens subtraction model

Success criteria
I can subtract tens and explain how the number changes.

OW-G1-166 E3 | Five questions

Name: _____ Date: _____

Work with a helper. Use objects, a number line, or a drawing to solve each problem.

1. A tub holds 50 cubes. 20 are used. Draw a model and find how many are left.

2. A tub holds 60 cubes. 30 are used. Draw a model and find how many are left.

3. A tub holds 70 cubes. 10 are used. Draw a model and find how many are left.

4. A tub holds 90 cubes. 40 are used. Draw a model and find how many are left.

5. Write a problem like question 1 with new numbers or objects. Solve it and show your work.

You can point, speak, draw, or write. Adults can note any help they give.



WORKSHEET OUTPOST | Grade 1 Math — Supported

Draw a tens subtraction model

Success criteria
I can subtract tens and explain how the number changes.

OW-G1-166 E4 | Five questions

Name: _____ Date: _____

Ask an adult to show you how to start. Then finish the problem together.

1. A tub holds 50 cubes. 20 are used. Draw a model and find how many are left.

2. A tub holds 60 cubes. 30 are used. Draw a model and find how many are left.

3. A tub holds 70 cubes. 10 are used. Draw a model and find how many are left.

4. A tub holds 90 cubes. 40 are used. Draw a model and find how many are left.

5. Write a problem like question 1 with new numbers or objects. Solve it and show your work.

You can point, speak, draw, or write. Adults can note any help they give.



WORKSHEET OUTPOST | Grade 1 Math — Supported

Draw a tens subtraction model

Success criteria
I can subtract tens and explain how the number changes.

OW-G1-166 E5 | Five questions

Name: _____ Date: _____

Try each problem. Tell an adult how you solved it. The adult can write down your answers.

1. A tub holds 50 cubes. 20 are used. Draw a model and find how many are left.

2. A tub holds 60 cubes. 30 are used. Draw a model and find how many are left.

3. A tub holds 70 cubes. 10 are used. Draw a model and find how many are left.

4. A tub holds 90 cubes. 40 are used. Draw a model and find how many are left.

5. Write a problem like question 1 with new numbers or objects. Solve it and show your work.

You can point, speak, draw, or write. Adults can note any help they give.