

WORKSHEET OUTPOST | Grade 1 Math — Supported

Draw a shape from clues

Success criteria
I can identify a shape by its sides and corners.

OW-G1-140 E1 | Five questions

Name: _____ Date: _____

Listen as an adult reads each question. Use counters or draw a picture to solve it.

1. Draw a closed shape with 3 straight sides. Name it.

2. Draw a square with 4 equal straight sides and 4 square corners.

3. Draw a rectangle that is not a square.

4. Draw a closed curved shape with no corners. Name it.

5. Draw a shape like one on this page. Name it and describe one thing you notice about it.

You can point, speak, draw, or write. Adults can note any help they give.



WORKSHEET OUTPOST | Grade 1 Math — Supported

Draw a shape from clues

Success criteria
I can identify a shape by its sides and corners.

OW-G1-140 E2 | Five questions

Name: _____ Date: _____

Work with a partner. Build a model, then say or write your answer.

1. Draw a closed shape with 3 straight sides. Name it.

2. Draw a square with 4 equal straight sides and 4 square corners.

3. Draw a rectangle that is not a square.

4. Draw a closed curved shape with no corners. Name it.

5. Draw a shape like one on this page. Name it and describe one thing you notice about it.

You can point, speak, draw, or write. Adults can note any help they give.



WORKSHEET OUTPOST | Grade 1 Math — Supported

Draw a shape from clues

Success criteria
I can identify a shape by its sides and corners.

OW-G1-140 E3 | Five questions

Name: _____ Date: _____

Work with a helper. Use objects, a number line, or a drawing to solve each problem.

1. Draw a closed shape with 3 straight sides. Name it.

2. Draw a square with 4 equal straight sides and 4 square corners.

3. Draw a rectangle that is not a square.

4. Draw a closed curved shape with no corners. Name it.

5. Draw a shape like one on this page. Name it and describe one thing you notice about it.

You can point, speak, draw, or write. Adults can note any help they give.



WORKSHEET OUTPOST | Grade 1 Math — Supported

Draw a shape from clues

Success criteria
I can identify a shape by its sides and corners.

OW-G1-140 E4 | Five questions

Name: _____ Date: _____

Ask an adult to show you how to start. Then finish the problem together.

1. Draw a closed shape with 3 straight sides. Name it.

2. Draw a square with 4 equal straight sides and 4 square corners.

3. Draw a rectangle that is not a square.

4. Draw a closed curved shape with no corners. Name it.

5. Draw a shape like one on this page. Name it and describe one thing you notice about it.

You can point, speak, draw, or write. Adults can note any help they give.



WORKSHEET OUTPOST | Grade 1 Math — Supported

Draw a shape from clues

Success criteria
I can identify a shape by its sides and corners.

OW-G1-140 E5 | Five questions

Name: _____ Date: _____

Try each problem. Tell an adult how you solved it. The adult can write down your answers.

1. Draw a closed shape with 3 straight sides. Name it.

2. Draw a square with 4 equal straight sides and 4 square corners.

3. Draw a rectangle that is not a square.

4. Draw a closed curved shape with no corners. Name it.

5. Draw a shape like one on this page. Name it and describe one thing you notice about it.

You can point, speak, draw, or write. Adults can note any help they give.