

WORKSHEET OUTPOST | Grade 1 Math — Supported

Work through a shape puzzle

Success criteria
I can put shapes together and name the shape I made.

OW-G1-160 E1 | Five questions

Name: _____ Date: _____

Listen as an adult reads each question. Use counters or draw a picture to solve it.

1. Can two equal triangles make a square? Draw a way or explain which triangles you need.

2. A child builds a flat 2-by-2 layer with 3 cubes. Is one cube missing? Draw to explain.

3. Can color alone tell you whether a shape is a triangle? Explain.

4. Can a sphere and a cube both have flat square faces? Explain.

5. Draw a shape like one on this page. Name it and describe one thing you notice about it.

You can point, speak, draw, or write. Adults can note any help they give.



WORKSHEET OUTPOST | Grade 1 Math — Supported

Work through a shape puzzle

Success criteria
I can put shapes together and name the shape I made.

OW-G1-160 E2 | Five questions

Name: _____ Date: _____

Work with a partner. Build a model, then say or write your answer.

1. Can two equal triangles make a square? Draw a way or explain which triangles you need.

2. A child builds a flat 2-by-2 layer with 3 cubes. Is one cube missing? Draw to explain.

3. Can color alone tell you whether a shape is a triangle? Explain.

4. Can a sphere and a cube both have flat square faces? Explain.

5. Draw a shape like one on this page. Name it and describe one thing you notice about it.

You can point, speak, draw, or write. Adults can note any help they give.



WORKSHEET OUTPOST | Grade 1 Math — Supported

Work through a shape puzzle

Success criteria
I can put shapes together and name the shape I made.

OW-G1-160 E3 | Five questions

Name: _____ Date: _____

Work with a helper. Use objects, a number line, or a drawing to solve each problem.

1. Can two equal triangles make a square? Draw a way or explain which triangles you need.

2. A child builds a flat 2-by-2 layer with 3 cubes. Is one cube missing? Draw to explain.

3. Can color alone tell you whether a shape is a triangle? Explain.

4. Can a sphere and a cube both have flat square faces? Explain.

5. Draw a shape like one on this page. Name it and describe one thing you notice about it.

You can point, speak, draw, or write. Adults can note any help they give.



WORKSHEET OUTPOST | Grade 1 Math — Supported

Work through a shape puzzle

Success criteria
I can put shapes together and name the shape I made.

OW-G1-160 E4 | Five questions

Name: _____ Date: _____

Ask an adult to show you how to start. Then finish the problem together.

1. Can two equal triangles make a square? Draw a way or explain which triangles you need.

2. A child builds a flat 2-by-2 layer with 3 cubes. Is one cube missing? Draw to explain.

3. Can color alone tell you whether a shape is a triangle? Explain.

4. Can a sphere and a cube both have flat square faces? Explain.

5. Draw a shape like one on this page. Name it and describe one thing you notice about it.

You can point, speak, draw, or write. Adults can note any help they give.



WORKSHEET OUTPOST | Grade 1 Math — Supported

Work through a shape puzzle

Success criteria
I can put shapes together and name the shape I made.

OW-G1-160 E5 | Five questions

Name: _____ Date: _____

Try each problem. Tell an adult how you solved it. The adult can write down your answers.

1. Can two equal triangles make a square? Draw a way or explain which triangles you need.

2. A child builds a flat 2-by-2 layer with 3 cubes. Is one cube missing? Draw to explain.

3. Can color alone tell you whether a shape is a triangle? Explain.

4. Can a sphere and a cube both have flat square faces? Explain.

5. Draw a shape like one on this page. Name it and describe one thing you notice about it.

You can point, speak, draw, or write. Adults can note any help they give.