

WORKSHEET OUTPOST | Grade 1 Math — Supported

Extra practice: true or false?

Success criteria
I can tell whether both sides of an equal sign have the same value.

OW-G1-074 E1 | Five questions

Name: _____ Date: _____

Listen as an adult reads each question. Use counters or draw a picture to solve it.

1. 2 + 4 = 6 Is the equation true or false?

2. 3 + 1 = 5 Is the equation true or false?

3. 4 + 2 = 6 Is the equation true or false?

4. 5 + 3 = 9 Is the equation true or false?

5. 6 + 4 = 10 Is the equation true or false?

You can point, speak, draw, or write. Adults can note any help they give.



WORKSHEET OUTPOST | Grade 1 Math — Supported

Extra practice: true or false?

Success criteria
I can tell whether both sides of an equal sign have the same value.

OW-G1-074 E2 | Five questions

Name: _____ Date: _____

Work with a partner. Build a model, then say or write your answer.

1. 2 + 4 = 6 Is the equation true or false?

2. 3 + 1 = 5 Is the equation true or false?

3. 4 + 2 = 6 Is the equation true or false?

4. 5 + 3 = 9 Is the equation true or false?

5. 6 + 4 = 10 Is the equation true or false?

You can point, speak, draw, or write. Adults can note any help they give.



WORKSHEET OUTPOST | Grade 1 Math — Supported

Extra practice: true or false?

Success criteria
I can tell whether both sides of an equal sign have the same value.

OW-G1-074 E3 | Five questions

Name: _____ Date: _____

Work with a helper. Use objects, a number line, or a drawing to solve each problem.

1. 2 + 4 = 6 Is the equation true or false?

2. 3 + 1 = 5 Is the equation true or false?

3. 4 + 2 = 6 Is the equation true or false?

4. 5 + 3 = 9 Is the equation true or false?

5. 6 + 4 = 10 Is the equation true or false?

You can point, speak, draw, or write. Adults can note any help they give.



WORKSHEET OUTPOST | Grade 1 Math — Supported

Extra practice: true or false?

Success criteria
I can tell whether both sides of an equal sign have the same value.

OW-G1-074 E4 | Five questions

Name: _____ Date: _____

Ask an adult to show you how to start. Then finish the problem together.

1. 2 + 4 = 6 Is the equation true or false?

2. 3 + 1 = 5 Is the equation true or false?

3. 4 + 2 = 6 Is the equation true or false?

4. 5 + 3 = 9 Is the equation true or false?

5. 6 + 4 = 10 Is the equation true or false?

You can point, speak, draw, or write. Adults can note any help they give.



WORKSHEET OUTPOST | Grade 1 Math — Supported

Extra practice: true or false?

Success criteria
I can tell whether both sides of an equal sign have the same value.

OW-G1-074 E5 | Five questions

Name: _____ Date: _____

Try each problem. Tell an adult how you solved it. The adult can write down your answers.

1. 2 + 4 = 6 Is the equation true or false?

2. 3 + 1 = 5 Is the equation true or false?

3. 4 + 2 = 6 Is the equation true or false?

4. 5 + 3 = 9 Is the equation true or false?

5. 6 + 4 = 10 Is the equation true or false?

You can point, speak, draw, or write. Adults can note any help they give.