

WORKSHEET OUTPOST | Grade 1 Math — Supported

Extra practice: compare categories

OW-G1-043 E1 | Five questions

Success criteria

I can use the counts in a graph or table to answer a question.

Name: _____ Date: _____

Listen as an adult reads each question. Use counters or draw a picture to solve it.

1. How many more votes did dogs get than fish?

Cats ○ ○
Dogs ○ ○ ○ ○
Fish ○

Each circle = 1 vote.

2. How many more votes did dogs get than fish?

Cats ○ ○ ○
Dogs ○ ○ ○ ○ ○
Fish ○ ○

Each circle = 1 vote.

3. How many more votes did dogs get than fish?

Cats ○ ○ ○ ○
Dogs ○ ○ ○ ○ ○ ○
Fish ○

Each circle = 1 vote.

4. How many more votes did dogs get than fish?

Cats ○ ○ ○ ○ ○
Dogs ○ ○ ○ ○
Fish ○ ○

Each circle = 1 vote.

5. How many more votes did dogs get than fish?

Cats ○ ○
Dogs ○ ○ ○ ○ ○
Fish ○

Each circle = 1 vote.

You can point, speak, draw, or write. Adults can note any help they give.



WORKSHEET OUTPOST | Grade 1 Math — Supported

Extra practice: compare categories

OW-G1-043 E2 | Five questions

Name: _____ Date: _____

Success criteria

I can use the counts in a graph or table to answer a question.

Work with a partner. Build a model, then say or write your answer.

1. How many more votes did dogs get than fish?

Cats	○ ○
Dogs	○ ○ ○ ○
Fish	○

Each circle = 1 vote.

2. How many more votes did dogs get than fish?

Cats	○ ○ ○
Dogs	○ ○ ○ ○ ○
Fish	○ ○

Each circle = 1 vote.

3. How many more votes did dogs get than fish?

Cats	○ ○ ○ ○
Dogs	○ ○ ○ ○ ○ ○
Fish	○

Each circle = 1 vote.

4. How many more votes did dogs get than fish?

Cats	○ ○ ○ ○ ○
Dogs	○ ○ ○ ○
Fish	○ ○

Each circle = 1 vote.

5. How many more votes did dogs get than fish?

Cats	○ ○
Dogs	○ ○ ○ ○ ○
Fish	○

Each circle = 1 vote.



WORKSHEET OUTPOST | Grade 1 Math — Supported

Extra practice: compare categories

OW-G1-043 E3 | Five questions

Success criteria

I can use the counts in a graph or table to answer a question.

Name: _____ Date: _____

Work with a helper. Use objects, a number line, or a drawing to solve each problem.

1. How many more votes did dogs get than fish?

Cats ○ ○
Dogs ○ ○ ○ ○
Fish ○

Each circle = 1 vote.

2. How many more votes did dogs get than fish?

Cats ○ ○ ○
Dogs ○ ○ ○ ○ ○
Fish ○ ○

Each circle = 1 vote.

3. How many more votes did dogs get than fish?

Cats ○ ○ ○ ○
Dogs ○ ○ ○ ○ ○ ○
Fish ○

Each circle = 1 vote.

4. How many more votes did dogs get than fish?

Cats ○ ○ ○ ○ ○
Dogs ○ ○ ○ ○
Fish ○ ○

Each circle = 1 vote.

5. How many more votes did dogs get than fish?

Cats ○ ○
Dogs ○ ○ ○ ○ ○
Fish ○

Each circle = 1 vote.

You can point, speak, draw, or write. Adults can note any help they give.



WORKSHEET OUTPOST | Grade 1 Math — Supported

Extra practice: compare categories

OW-G1-043 E4 | Five questions

Success criteria
I can use the counts in a graph or table to answer a question.

Name: _____ Date: _____

Ask an adult to show you how to start. Then finish the problem together.

1. How many more votes did dogs get than fish?

Cats ○ ○
Dogs ○ ○ ○ ○
Fish ○

Each circle = 1 vote.

2. How many more votes did dogs get than fish?

Cats ○ ○ ○
Dogs ○ ○ ○ ○ ○
Fish ○ ○

Each circle = 1 vote.

3. How many more votes did dogs get than fish?

Cats ○ ○ ○ ○
Dogs ○ ○ ○ ○ ○ ○
Fish ○

Each circle = 1 vote.

4. How many more votes did dogs get than fish?

Cats ○ ○ ○ ○ ○
Dogs ○ ○ ○ ○
Fish ○ ○

Each circle = 1 vote.

5. How many more votes did dogs get than fish?

Cats ○ ○
Dogs ○ ○ ○ ○ ○
Fish ○

Each circle = 1 vote.

You can point, speak, draw, or write. Adults can note any help they give.



WORKSHEET OUTPOST | Grade 1 Math — Supported

Extra practice: compare categories

OW-G1-043 E5 | Five questions

Success criteria

I can use the counts in a graph or table to answer a question.

Name: _____ Date: _____

Try each problem. Tell an adult how you solved it. The adult can write down your answers.

1. How many more votes did dogs get than fish?

Cats ○ ○
Dogs ○ ○ ○ ○
Fish ○

Each circle = 1 vote.

2. How many more votes did dogs get than fish?

Cats ○ ○ ○
Dogs ○ ○ ○ ○ ○
Fish ○ ○

Each circle = 1 vote.

3. How many more votes did dogs get than fish?

Cats ○ ○ ○ ○
Dogs ○ ○ ○ ○ ○ ○
Fish ○

Each circle = 1 vote.

4. How many more votes did dogs get than fish?

Cats ○ ○ ○ ○ ○
Dogs ○ ○ ○ ○
Fish ○ ○

Each circle = 1 vote.

5. How many more votes did dogs get than fish?

Cats ○ ○
Dogs ○ ○ ○ ○ ○
Fish ○

Each circle = 1 vote.

You can point, speak, draw, or write. Adults can note any help they give.