

WORKSHEET OUTPOST | Grade 1 Math — Supported

Extra practice: compare in stories

OW-G1-121 E1 | Five questions

Success criteria
I can compare two numbers by looking at their place values.

Name: _____ Date: _____

Listen as an adult reads each question. Use counters or draw a picture to solve it.

1. Box A has 22 blocks. Box B has 12 blocks. Which has more, or are they equal?

2. Box A has 33 blocks. Box B has 36 blocks. Which has more, or are they equal?

3. Box A has 44 blocks. Box B has 44 blocks. Which has more, or are they equal?

4. Box A has 51 blocks. Box B has 61 blocks. Which has more, or are they equal?

5. Box A has 62 blocks. Box B has 60 blocks. Which has more, or are they equal?

You can point, speak, draw, or write. Adults can note any help they give.



WORKSHEET OUTPOST | Grade 1 Math — Supported

Extra practice: compare in stories

OW-G1-121 E2 | Five questions

Success criteria
I can compare two numbers by looking at their place values.

Name: _____ Date: _____

Work with a partner. Build a model, then say or write your answer.

1. Box A has 22 blocks. Box B has 12 blocks. Which has more, or are they equal?

2. Box A has 33 blocks. Box B has 36 blocks. Which has more, or are they equal?

3. Box A has 44 blocks. Box B has 44 blocks. Which has more, or are they equal?

4. Box A has 51 blocks. Box B has 61 blocks. Which has more, or are they equal?

5. Box A has 62 blocks. Box B has 60 blocks. Which has more, or are they equal?

You can point, speak, draw, or write. Adults can note any help they give.



WORKSHEET OUTPOST | Grade 1 Math — Supported

Extra practice: compare in stories

OW-G1-121 E3 | Five questions

Success criteria
I can compare two numbers by looking at their place values.

Name: _____ Date: _____

Work with a helper. Use objects, a number line, or a drawing to solve each problem.

1. Box A has 22 blocks. Box B has 12 blocks. Which has more, or are they equal?

2. Box A has 33 blocks. Box B has 36 blocks. Which has more, or are they equal?

3. Box A has 44 blocks. Box B has 44 blocks. Which has more, or are they equal?

4. Box A has 51 blocks. Box B has 61 blocks. Which has more, or are they equal?

5. Box A has 62 blocks. Box B has 60 blocks. Which has more, or are they equal?

You can point, speak, draw, or write. Adults can note any help they give.



WORKSHEET OUTPOST | Grade 1 Math — Supported

Extra practice: compare in stories

Success criteria
I can compare two numbers by looking at their place values.

OW-G1-121 E4 | Five questions

Name: _____ Date: _____

Ask an adult to show you how to start. Then finish the problem together.

1. Box A has 22 blocks. Box B has 12 blocks. Which has more, or are they equal?

2. Box A has 33 blocks. Box B has 36 blocks. Which has more, or are they equal?

3. Box A has 44 blocks. Box B has 44 blocks. Which has more, or are they equal?

4. Box A has 51 blocks. Box B has 61 blocks. Which has more, or are they equal?

5. Box A has 62 blocks. Box B has 60 blocks. Which has more, or are they equal?

You can point, speak, draw, or write. Adults can note any help they give.



WORKSHEET OUTPOST | Grade 1 Math — Supported

Extra practice: compare in stories

OW-G1-121 E5 | Five questions

Success criteria
I can compare two numbers by looking at their place values.

Name: _____ Date: _____

Try each problem. Tell an adult how you solved it. The adult can write down your answers.

1. Box A has 22 blocks. Box B has 12 blocks. Which has more, or are they equal?

2. Box A has 33 blocks. Box B has 36 blocks. Which has more, or are they equal?

3. Box A has 44 blocks. Box B has 44 blocks. Which has more, or are they equal?

4. Box A has 51 blocks. Box B has 61 blocks. Which has more, or are they equal?

5. Box A has 62 blocks. Box B has 60 blocks. Which has more, or are they equal?

You can point, speak, draw, or write. Adults can note any help they give.