

WORKSHEET OUTPOST | Grade 1 Math — Supported

Extra practice: count length units

OW-G1-108 E1 | Five questions

Success criteria

I can use the length units shown to measure and compare the strips.

Name: _____ Date: _____

Listen as an adult reads each question. Use counters or draw a picture to solve it.

1. How many units long is strip A?

A □□

2. How many units long is strip A?

A □□□

3. How many units long is strip A?

A □□□□

4. How many units long is strip A?

A □□□□□

5. How many units long is strip A?

A □□□□□□

You can point, speak, draw, or write. Adults can note any help they give.



WORKSHEET OUTPOST | Grade 1 Math — Supported

Extra practice: count length units

OW-G1-108 E2 | Five questions

Success criteria

I can use the length units shown to measure and compare the strips.

Name: _____ Date: _____

Work with a partner. Build a model, then say or write your answer.

1. How many units long is strip A?

A

2. How many units long is strip A?

A

3. How many units long is strip A?

A

4. How many units long is strip A?

A

5. How many units long is strip A?

A

You can point, speak, draw, or write. Adults can note any help they give.



WORKSHEET OUTPOST | Grade 1 Math — Supported

Extra practice: count length units

OW-G1-108 E3 | Five questions

Success criteria

I can use the length units shown to measure and compare the strips.

Name: _____ Date: _____

Work with a helper. Use objects, a number line, or a drawing to solve each problem.

1. How many units long is strip A?

A □□

2. How many units long is strip A?

A □□□

3. How many units long is strip A?

A □□□□

4. How many units long is strip A?

A □□□□□

5. How many units long is strip A?

A □□□□□□

You can point, speak, draw, or write. Adults can note any help they give.



WORKSHEET OUTPOST | Grade 1 Math — Supported

Extra practice: count length units

OW-G1-108 E4 | Five questions

Success criteria

I can use the length units shown to measure and compare the strips.

Name: _____ Date: _____

Ask an adult to show you how to start. Then finish the problem together.

1. How many units long is strip A?

A □□

2. How many units long is strip A?

A □□□

3. How many units long is strip A?

A □□□□

4. How many units long is strip A?

A □□□□□

5. How many units long is strip A?

A □□□□□□

You can point, speak, draw, or write. Adults can note any help they give.



WORKSHEET OUTPOST | Grade 1 Math — Supported

Extra practice: count length units

OW-G1-108 E5 | Five questions

Success criteria

I can use the length units shown to measure and compare the strips.

Name: _____ Date: _____

Try each problem. Tell an adult how you solved it. The adult can write down your answers.

1. How many units long is strip A?

A □□

2. How many units long is strip A?

A □□□

3. How many units long is strip A?

A □□□□

4. How many units long is strip A?

A □□□□□

5. How many units long is strip A?

A □□□□□□

You can point, speak, draw, or write. Adults can note any help they give.