

WORKSHEET OUTPOST | Grade 1 Math — Supported

Extra practice: compare two lengths

OW-G1-107 E1 | Five questions

Success criteria
I can compare the lengths and tell which is longer or shorter.

Name: _____ Date: _____

Listen as an adult reads each question. Use counters or draw a picture to solve it.

1. Which strip is longer: A or B?

A □□
B □□□□

2. Which strip is longer: A or B?

A □□□
B □□□□□

3. Which strip is longer: A or B?

A □□□□
B □□□□□□

4. Which strip is longer: A or B?

A □□□□□
B □□□□□□□

5. Which strip is longer: A or B?

A □□□□□□
B □□□□□□□□

You can point, speak, draw, or write. Adults can note any help they give.



WORKSHEET OUTPOST | Grade 1 Math — Supported

Extra practice: compare two lengths

OW-G1-107 E2 | Five questions

Success criteria
I can compare the lengths and tell which is longer or shorter.

Name: _____ Date: _____

Work with a partner. Build a model, then say or write your answer.

1. Which strip is longer: A or B?

A □□
B □□□□

2. Which strip is longer: A or B?

A □□□
B □□□□□

3. Which strip is longer: A or B?

A □□□□
B □□□□□□

4. Which strip is longer: A or B?

A □□□□□
B □□□□□□□

5. Which strip is longer: A or B?

A □□□□□□
B □□□□□□□□

You can point, speak, draw, or write. Adults can note any help they give.



WORKSHEET OUTPOST | Grade 1 Math — Supported

Extra practice: compare two lengths

OW-G1-107 E3 | Five questions

Success criteria
I can compare the lengths and tell which is longer or shorter.

Name: _____ Date: _____

Work with a helper. Use objects, a number line, or a drawing to solve each problem.

1. Which strip is longer: A or B?

A □□
B □□□□

2. Which strip is longer: A or B?

A □□□
B □□□□□

3. Which strip is longer: A or B?

A □□□□
B □□□□□□

4. Which strip is longer: A or B?

A □□□□□
B □□□□□□□

5. Which strip is longer: A or B?

A □□□□□□
B □□□□□□□□

You can point, speak, draw, or write. Adults can note any help they give.



WORKSHEET OUTPOST | Grade 1 Math — Supported

Extra practice: compare two lengths

OW-G1-107 E4 | Five questions

Success criteria
I can compare the lengths and tell which is longer or shorter.

Name: _____ Date: _____

Ask an adult to show you how to start. Then finish the problem together.

1. Which strip is longer: A or B?

A □□
B □□□□

2. Which strip is longer: A or B?

A □□□
B □□□□□

3. Which strip is longer: A or B?

A □□□□
B □□□□□□

4. Which strip is longer: A or B?

A □□□□□
B □□□□□□□

5. Which strip is longer: A or B?

A □□□□□□
B □□□□□□□□

You can point, speak, draw, or write. Adults can note any help they give.



WORKSHEET OUTPOST | Grade 1 Math — Supported

Extra practice: compare two lengths

OW-G1-107 E5 | Five questions

Success criteria
I can compare the lengths and tell which is longer or shorter.

Name: _____ Date: _____

Try each problem. Tell an adult how you solved it. The adult can write down your answers.

1. Which strip is longer: A or B?

A □□
B □□□□

2. Which strip is longer: A or B?

A □□□
B □□□□□

3. Which strip is longer: A or B?

A □□□□
B □□□□□□

4. Which strip is longer: A or B?

A □□□□□
B □□□□□□□

5. Which strip is longer: A or B?

A □□□□□□
B □□□□□□□□

You can point, speak, draw, or write. Adults can note any help they give.