

WORKSHEET OUTPOST | Grade 1 Math — Supported

Extra practice: time and money practice

OW-G1-194 E1 | Five questions

Success criteria
I can read the hands on a clock and tell the time.

Name: _____ Date: _____

Listen as an adult reads each question. Use counters or draw a picture to solve it.

1. Write the time shown.



2. You have 3 nickels. How many cents?

3. Write the time shown.



4. You have 5 nickels. How many cents?

5. Write the time shown.



You can point, speak, draw, or write. Adults can note any help they give.



WORKSHEET OUTPOST | Grade 1 Math — Supported

Extra practice: time and money practice

OW-G1-194 E2 | Five questions

Name: _____ Date: _____

Success criteria

I can read the hands on a clock and tell the time.

Work with a partner. Build a model, then say or write your answer.

1. Write the time shown.



2. You have 3 nickels. How many cents?

3. Write the time shown.



4. You have 5 nickels. How many cents?

5. Write the time shown.



You can point, speak, draw, or write. Adults can note any help they give.



WORKSHEET OUTPOST | Grade 1 Math — Supported

Extra practice: time and money practice

OW-G1-194 E3 | Five questions

Success criteria
I can read the hands on a clock and tell the time.

Name: _____ Date: _____

Work with a helper. Use objects, a number line, or a drawing to solve each problem.

1. Write the time shown.



2. You have 3 nickels. How many cents?

3. Write the time shown.



4. You have 5 nickels. How many cents?

5. Write the time shown.



You can point, speak, draw, or write. Adults can note any help they give.



WORKSHEET OUTPOST | Grade 1 Math — Supported

Extra practice: time and money practice

OW-G1-194 E4 | Five questions

Success criteria
I can read the hands on a clock and tell the time.

Name: _____ Date: _____

Ask an adult to show you how to start. Then finish the problem together.

1. Write the time shown.



2. You have 3 nickels. How many cents?

3. Write the time shown.



4. You have 5 nickels. How many cents?

5. Write the time shown.



You can point, speak, draw, or write. Adults can note any help they give.



WORKSHEET OUTPOST | Grade 1 Math — Supported

Extra practice: time and money practice

OW-G1-194 E5 | Five questions

Success criteria
I can read the hands on a clock and tell the time.

Name: _____ Date: _____

Try each problem. Tell an adult how you solved it. The adult can write down your answers.

1. Write the time shown.



2. You have 3 nickels. How many cents?

3. Write the time shown.



4. You have 5 nickels. How many cents?

5. Write the time shown.



You can point, speak, draw, or write. Adults can note any help they give.